名字 _____

复习
1-5

顺序三个数字

数字线可以帮你找到数字.

27 38 14

写下最小到最大.

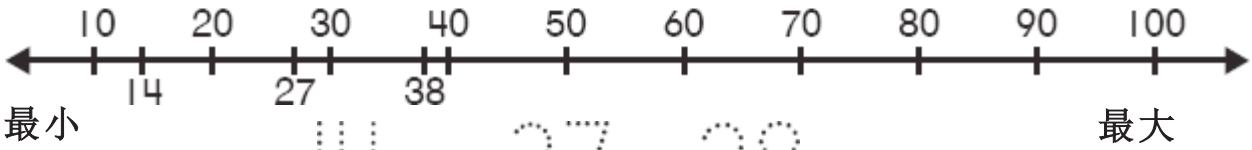

14 27 38

_____ _____ _____

最小 最大

1.

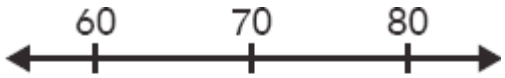

67 76 70

67 70 76

_____ _____ _____

最小 最大

2.

53 43 34

_____ _____ _____

最小 最大

3.

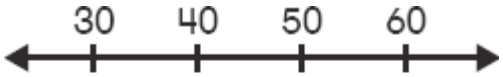

47 32 51

_____ _____ _____

最小 最大

4.

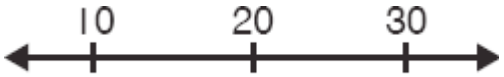

16 6 26

_____ _____ _____

最小 最大

Copyright © Pearson Education, Inc., or its affiliates. All Rights Reserved. 1